Angles as Turns: Free Practice Worksheet

Class 5 · Maths · Chapter 3, Maths Mela · Home Practice

Name: _____ Roll No.: _____

Attempt all questions · *Max marks*: 5

Q1. Look at the clock. What kind of angle do the hour hand and the minute hand make? [1 mark]

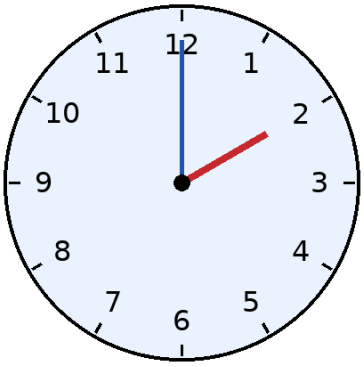

(A) acute

(B) right angle

(C) obtuse

(D) straight angle

Answer: _____

Q2. Look at the folded circle. The shaded part shows a turn that starts at the top. How much of a turn is it, and in which direction? [1 mark]

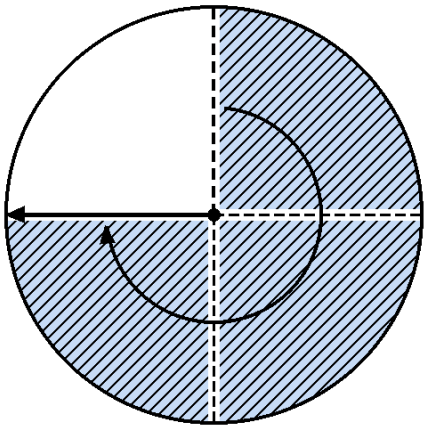

(A) $\frac{1}{4}$ of a turn, clockwise

(B) $\frac{3}{4}$ of a turn, anti-clockwise

(C) $\frac{3}{4}$ of a turn, clockwise

(D) $\frac{1}{4}$ of a turn, anti-clockwise

Answer: _____

Q3. Look at the shape PQRS. Which of its angles is obtuse? [1 mark]

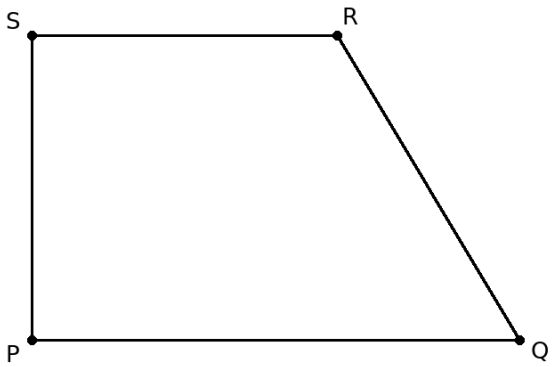

(A) the angle at P

(B) the angle at Q

(C) the angle at R

(D) the angle at S

Answer: _____

Q4. Two quarter turns clockwise end in the same position as two quarter turns anti-clockwise. [1 mark]

True / False

Q5. In 45 minutes, the minute hand of a clock turns through _____ right angles. [1 mark]

Answer: _____

Answers

Angles as Turns: *Free Practice Worksheet* · 5 *questions* · 5 *marks*.

Q1	Option A — acute
Q2	Option C — $\frac{3}{4}$ of a turn, clockwise
Q3	Option C — the angle at R
Q4	True
Q5	3

More Angles as Turns practice, with a worked explanation for every question: *claylearn.in/maths/class-5/angles-as-turns*