Data Handling: Free Practice Worksheet

Class 2 · Maths · Chapter 11, Joyful Mathematics · Home Practice

Name: _____ Roll No.: _____

Attempt all questions · *Max marks*: 5

Q1. Children chose their favourite game. Look at the pictograph. One smiley stands for 1 child. Which game did the fewest children choose? [1 mark]



(A) Kho-kho

(B) Cricket

(C) Kabaddi

(D) Hopscotch

Answer: _____

Q2. Class 2 made a table of their favourite season. [1 mark]

Season	Children
Summer	**7**
Rainy	**9**
Winter	**6**

How many children chose a season in all?

(A) 22

(B) 9

(C) 21

(D) 3

Answer: _____

Q3. Arun counted the birds he saw in the park. [1 mark]

Bird	How many
Crow	**8**
Sparrow	**5**
Pigeon	**9**
Myna	**3**

Which list goes from the most birds to the fewest birds?

(A) Myna, Sparrow, Crow, Pigeon

(B) Pigeon, Crow, Sparrow, Myna

(C) Crow, Pigeon, Sparrow, Myna

(D) Pigeon, Crow, Myna, Sparrow

Answer: _____

Q4. Look at the balloons. Raju counts them and says there are 6 balloons. Raju is right. [1 mark]



True / False

Q5. The pictograph shows how many storybooks each child read this month. One book picture stands for 1 storybook. Meena and Arjun read _____ storybooks in all. [1 mark]

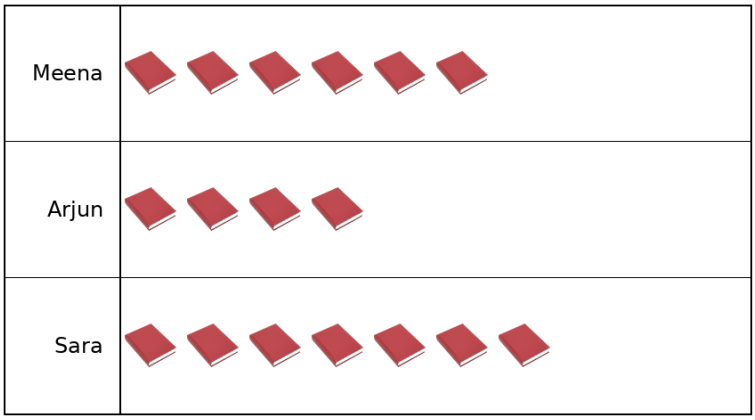

Answer: _____

Answers

Data Handling: *Free Practice Worksheet* · 5 *questions* · 5 *marks*.

Q1	Option C — Kabaddi
Q2	Option A — 22
Q3	Option B — Pigeon, Crow, Sparrow, Myna
Q4	False
Q5	10

More Data Handling practice, with a worked explanation for every question: *claylearn.in/maths/class-2/data-handling*