Making 10: Free Practice Worksheet

Class 1 · Maths · Chapter 4, Joyful Mathematics · Home Practice

Name: _____ Roll No.: _____

Attempt all questions · *Max marks*: 5

Q1. Look at the picture. How many balls are inside the basket? [1 mark]



(A) 0

(B) 1

(C) 4

(D) 5

Answer: _____

Q2. Meena wears 10 bangles in all. She has 6 bangles on her left hand. How many bangles are on her right hand? [1 mark]

(A) 4

(B) 6

(C) 10

(D) 16

Answer: _____

Q3. Look at the sticks. The bundle has 10 sticks. What number do all the sticks show? [1 mark]

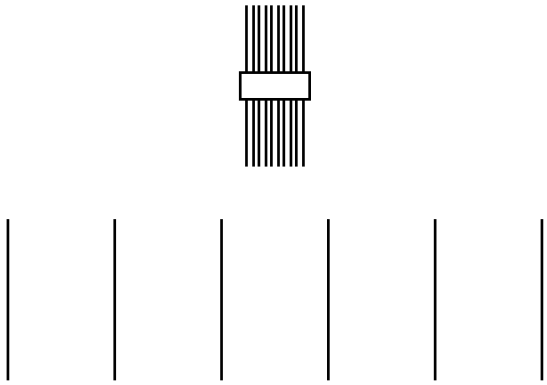

(A) 7

(B) 15

(C) 16

(D) 61

Answer: _____

Q4. Look at the sticks. The left side shows 12. The right side shows 9. 12 is less than 9. [1 mark]

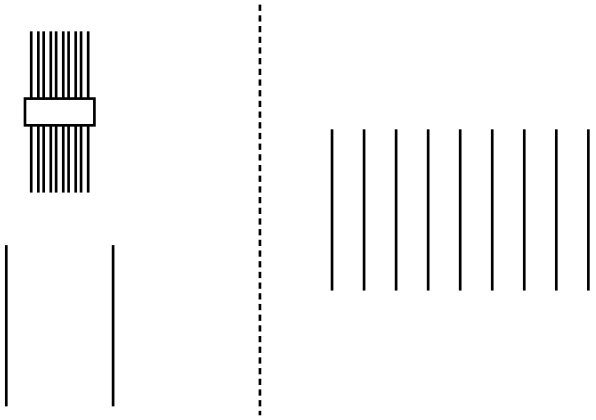

True / False

Q5. Ali's team has 5 children. 2 of them are girls. _____ of them are boys. [1 mark]

Answer: _____

Answers

Making 10: *Free Practice Worksheet* · 5 *questions* · 5 *marks*.

Q1	Option A — 0
Q2	Option A — 4
Q3	Option C — 16
Q4	False
Q5	3

More Making 10 *practice*, *with a worked explanation for every question*: *claylearn.in*/*maths*/*class*-1/*making*-10