# Lina’s Family: Free Practice Worksheet

Class 1 · Maths · Chapter 7, Joyful Mathematics · Home Practice

Name: _____ Roll No.: _____

*Attempt all questions · Max marks*: 5

**Q1.** Look at the balance. One pumpkin is on one side. Five tomatoes are on the other side. The pumpkin is _____ than the five tomatoes. [1 mark]

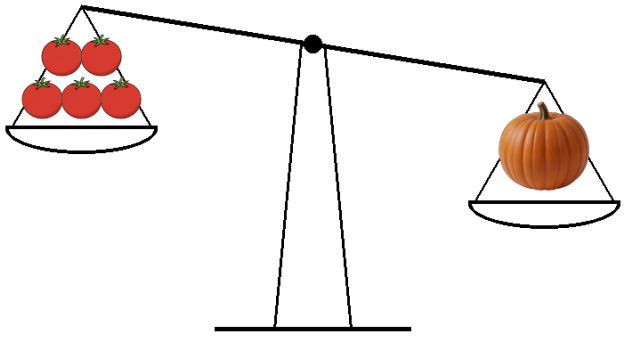

**(A)** lighter

**(B)** heavier

**(C)** taller

**(D)** thinner

Answer: _____

**Q2.** Raju measures his table with erasers. Then he measures the same table with pencils. A pencil is longer than an eraser. What will he find? [1 mark]

**(A)** He needs more pencils than erasers.

**(B)** He needs the same number of each.

**(C)** He needs more erasers than pencils.

**(D)** The table gets longer.

Answer: _____

**Q3.** Which of these needs the most water? [1 mark]

**(A)** a glass of water to drink

**(B)** a cup of tea

**(C)** a spoon of water

**(D)** a bath for a child

Answer: _____

**Q4.** Look at the picture. Child B is taller than child A. [1 mark]

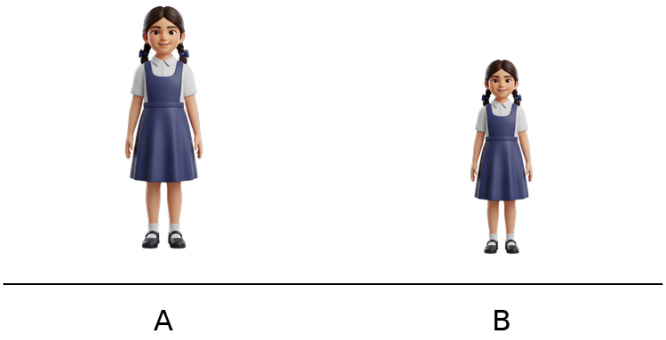


True / False

**Q5.** Look at the picture. Erasers are placed in a line below the ribbon. The ribbon is as long as _____ erasers. [1 mark]

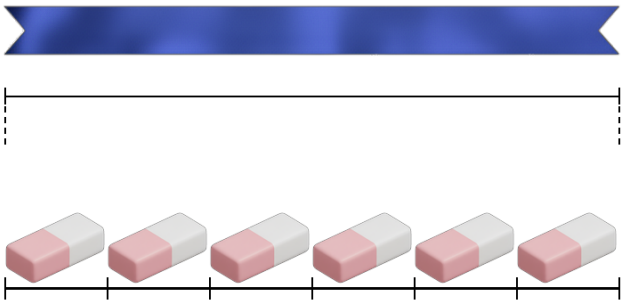

Answer: _____

## Answers

*Lina's Family*: *Free Practice Worksheet* · 5 *questions* · 5 *marks*.

| | |
|---|---|
| **Q1** | Option B — heavier |
| **Q2** | Option C — He needs more erasers than pencils. |
| **Q3** | Option D — a bath for a child |
| **Q4** | False |
| **Q5** | 6 |

*More Lina's Family practice, with a worked explanation for every question*: *claylearn.in/maths/class-1/linas-family*